
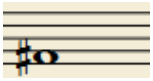
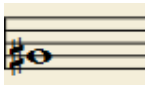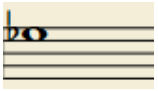
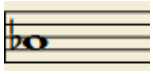
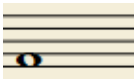
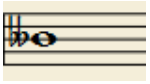




Ejercicios de Construcción de Intervalos (2)

1) Escribe la nota que falta para formar el intervalo indicado:

3ª menor ascendente 	4ª justa ascendente 	4ª justa descendente 	6ª menor ascendente 
3ª menor ascendente 	3ª menor descendente 	6ª menor ascendente 	4ª justa ascendente 

2) Escribe la nota que falta para formar el intervalo indicado:

4ª justa ascendente 	4ª justa ascendente 	7ª menor ascendente 	4ª justa descendente 
6ª menor descendente 	2ª Mayor descendente 	2ª Mayor descendente 	4ª Aumentada Ascendente 

© Juanjo Llopico